BYJU'S EXAM PREP

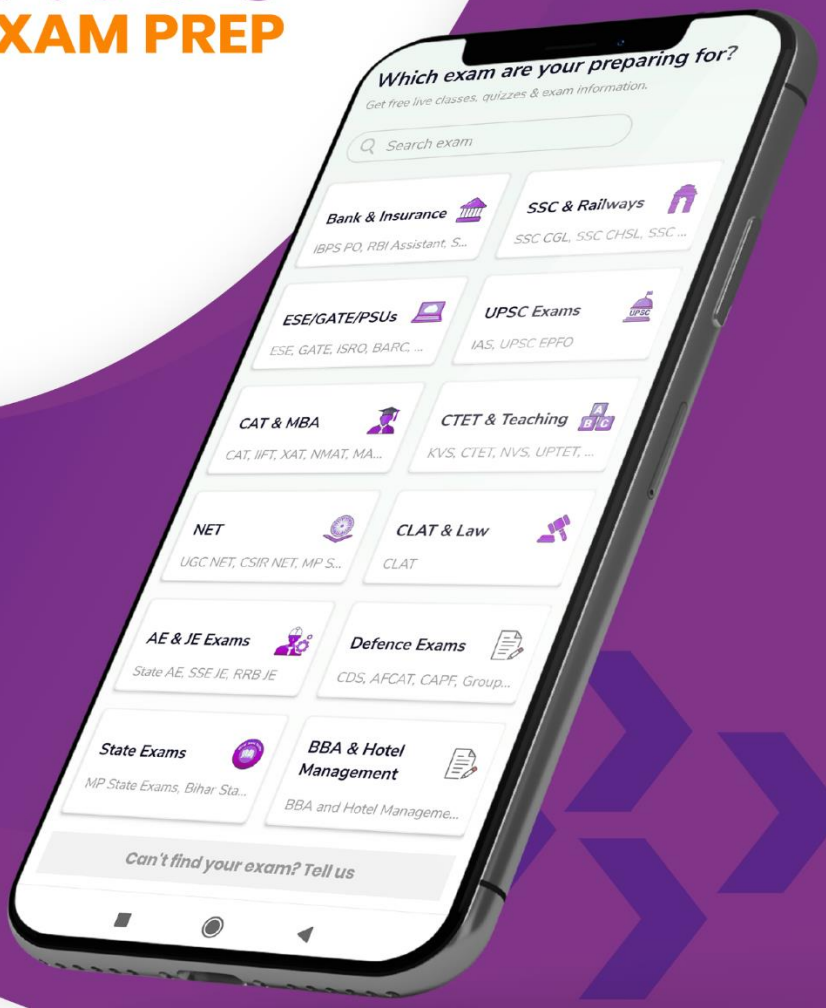

Questions Asked in SSC CGL 11 April 2022 Exam (Shift 1, 2 and 3) English PDF

GET IT ON Google Play

Questions Asked in SSC CGL 11 April 2022 Exam (Shift 1, 2 and 3)

SSC CGL 11 April 2022 Exam General Awareness Question Asked (All Shifts)

General Awareness Questions asked in Shift 1:

1. CM of Uttarakhand?
Ans:Pushkar singh Dhami

2. World water day
Ans:22 march , since 1993 theme- "Groundwater, making the invisible visible"

3. IMF Chief Economist
Ans:Pierre-Olivier Gourinchas

4. Battle of Chanderi was fought between?
Ans- Babur and Medini Rai - 1528

5. White Mountain is situated in which country?
Ans:United States.

6. Article 213 related to___
Ans:Power of Governor to promulgate Ordinances during recess of Legislature

7. Who discovered vitamin?
Ans:Casimir Funk

8. Who won the PETA 2021 prize?
Ans:Alia Bhatt

9. Recently elections conducting states
Ans:Uttar Pr adesh, Punjab, Uttarakhand, Manipur and Goa .

10. When is wetland day celebrated
Ans:2 February

11. Who built Konark Sun Temple?
Ans: Narasimhadeva- I in Odisha

12. Gulf of khambhat is located in which state?
Ans: Gujarat

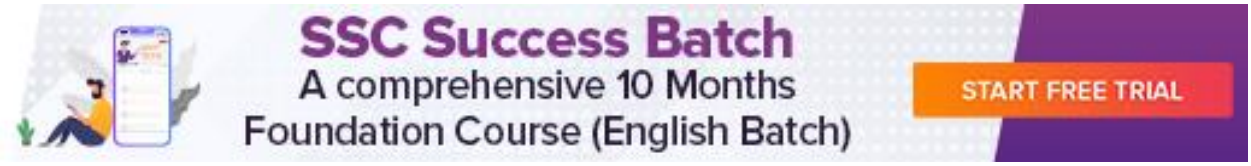

13. What is the scientific study of earthquakes called?
Ans:Seismology'.

14. DPSP is borrowed from the constitution of which country?
Ans: Ireland

15. How much amount is allocated to health sector in budget 2022-23?

16. Ans: Rs. 86,200.65 crore,0.23 per cent higher than the revised estimate of Rs. 86,000.65 crore in 2021-22.

17. The book Democrats and dissenters has been authored by whom?
Ans: Ramachandra Guha

18. Aricle 51 is related to_____

Ans: Promotion of international peace and security

General Awareness Questions asked in Shift 2:

1. Poverty and un-British rule in India is written by
Ans:Dadabhai Naoroji

2. ELECTION Commission come under which Article
Ans: Article 324

3. Musi river is tributary of_____
Ans:Krishna

4. What CH3CH2OH called?
Ans:ethanol

5. What is the theme of the World heritage Day 2022?
Ans: Heritage and Climate

6. Where was the 1931 session of Indian National Congress held?
Ans:Karachi

7. One question related to Padma bhushan award

8. When did ASHA program start?
Ans: 2006

9. Who is current chief justice of india?
Ans: Nuthalapati Venkata Ramana

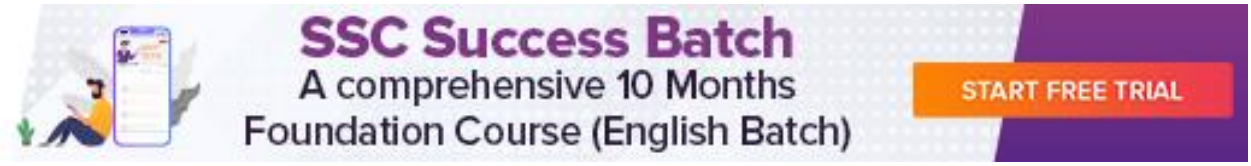

10. Sunil chhetri related to which sports?
Ans: Football

11. Who is chairman of Padma award committee?
Ans: Cabinet Secretary

12. Kalinga award associated with which state?
Ans: Odisha

General Awareness Questions asked in Shift 3:

1. City on bank of Krishna river?
Ans. Vijaywada

2. Delhi is First time capital city of which ruler?
Ans. tomar rajput

3. Nepal Army General Title award
Ans. Mukund Narvane

4. Current CJI N.V Ramana belongs to which state?
Ans. Andhra pradesh

5. What is average weight of human heart?
Ans:250-350 g

6. Question related to monosaccharide

7. Buffalo race of tamilnadu
Ans. jallikattu

8. In delhi sultanate period who shifted his capital from delhi?

Ans: Muhammad bin Tughluq.

9.The total number of chromosomes in a normal human body?

Ans: 46

10.Right to education 2009 implemented in?

Ans. 2010

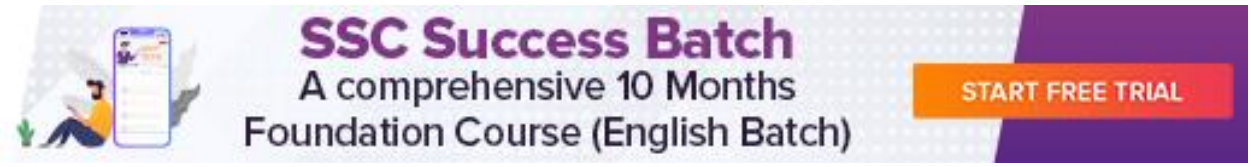

11. Question on septic tank

12. Till which year Fiscal deficit will be reduced to 4.7% ?

Ans. 2024-25

13. 13.What is the minimum support price fixed by the government of Groundnut?

Ans: 5550 per quintal

14. 14.How many female members in constituent assembly?

Ans: 15

25. 15.Buxa fort is located in which state?

Ans: West Bengal

English Questions asked in Shift 1:

1. Voice - simple past

2. Narration - Imperative sentence

3. Error - Subject Verb agreement

4. Cloze Test - On Irrawaddy dolphin

5. Idiom - to have same breath

6. Error - Article

7. Ant - evade, Raze

8. Spelling - Mission

9. Spelling - Tuition

10. OWS- to roam aimlessly

11. Synonym/ anto - Avert, modest

12. OWS - study of earthquake - Seismology

13. Idiom - be hard up

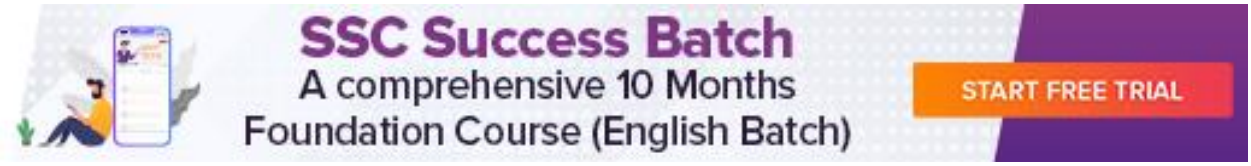

English Questions asked in Shift 2:

1. Fill in the blanks - preposition
2. Syno/anto - Taciturn
3. Anto - Rough
4. Cloze test - Exercise is important to prevent heart disease.
5. Syno/anto - Tenacious
6. Voice - simple past
7. Narration - imperative
8. Error spotting - preposition - "During"
9. One word substitution - strut
10. Error - Subject verb agreement
11. Fill in the blanks – noun

English Questions asked in Shift 3:

1.Synonym - Smooth
2. Error spotting - No sooner …. Than
3. Idiom - Bite off more than you can chew (something related to this)
4. Voice - Past perfect continuous tense
5. One word - Aquarium
6. Cloze test - Child education
7. Spelling - Weird
8. Antonym – Criticize

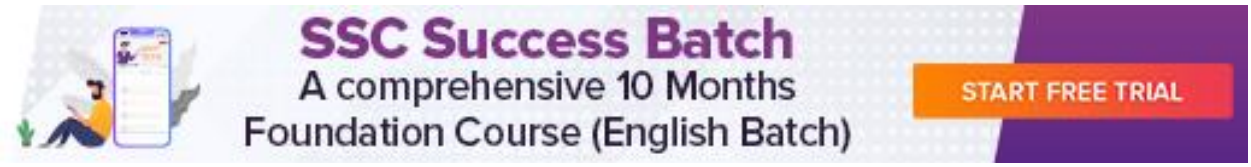

Reasoning Questions asked in Shift 1:

1. Mirror Image - DETECTOR / ЯOTƆƎTƎD

2. No. Series - difference and multiply Ans: 1110

3. No. Series -

4. Letter Analogy - 3 ques (1 based on coding)

5. Arrangement of words in logical order

6. Distance Direction

7. Blood Relation - coded

8. Syllogism - 2 statements 2 Conclusion

Statements -

All Flower are pretty

All Pretty are Pots

9. Venn Diagram - Male, Female, Father

10. Sitting Arrangement - Linear Based (6 people)

11. Dice - Closed Dice - 2 images was given

Reasoning Questions asked in Shift 2:

1. Number Analogy - 23: 529 :: 44 : ? (Ans 1936)

2. Number Series - 2, 23, 44, 65, ?, 107 (Ans - 86)

3. Blood Relations (coded) - 2 questions

4. Dice - 1 Open

5. Sitting Arrangement - Linear

6. Cube and Dice - Dice 1 - 2,3,4 and Dice 2 - 2,6,4 . find out which number is opposite to 3.

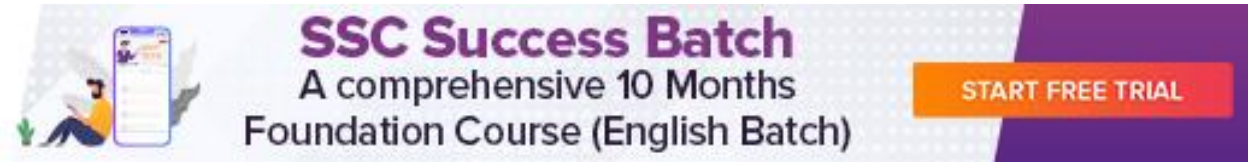
SSC Success Batch
A comprehensive 10 Months
Foundation Course (English Batch)
START FREE TRIAL

7. Embedded fig - 1 Question

8. Logical Venn Diagram - Representation Based(Triangle represent …., Square, Circle)

9. Mirror Image - P@QOVW%$

10. Coding Decoding - 3 questions

11. Missing No. - 1 Question

12. Paper Cutting and Folding - 1 ques

13. Fig Series - 2 ques

14. Syllogism - (i) No White is Yellow (ii) No Yellow is Red (iii) All Purple is Yellow

15. Math op - 1 ques

16. Venn Diagram - Representative - Hexagon, Pentagon, Circle, Square.

17. Classification - Shark, Blue Whale, Penguin, _____

Reasoning Questions asked in Shift 3:

☐ Venn Diagram - Doctor, Female, Married

☐ Mirror Image - Alphanumeric

☐ Syllogism - (i) Some Bat are Ball

☐ Math op - + and - need to be swapped to obtain the correct answer.

☐ Paper Cutting

☐ Blood Relation - Coded

☐ Coding Decoding - 2 questions, 1 based on reverse positions

☐ Missing No. - Matrix based, 3 x 3, middle no. missing

☐ No. Series - 17, 16, 32, 29, ? (-1, x2, -3, x4) Ans: 116

☐ Embedded Fig

☐ Direction - Mixture of angle and distance

☐ Odd one out - (i) PRTV (ii) DFHJ (iii) WAEI (iv) MOQS (Ans: WAEI gaps of +4)

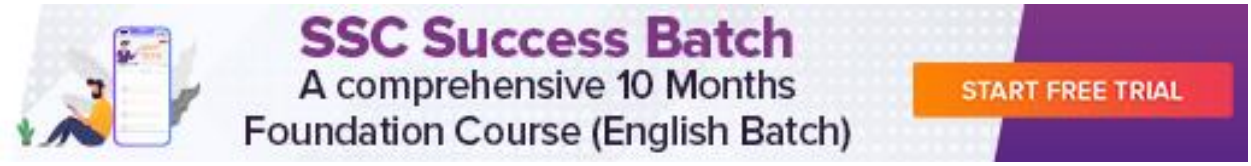

Quantitative Aptitude Questions asked in Shift 1:

1. Successive discount

2. Time and distance - train

3.Pipe& cistern - 1 Qn

4. Geometry- Triangle - 1 Qn

5.D.I - 3 Qns easy

6. Simplification - 1 qn

7. Time & work - 1qn

8. If p =101 cube root of p(p square - 3p +3)-1

Ans: 100

9. A can complete the work in 20 days and B can complete the same work in 16 days. They work together for 4 days then A left, in how many days B completed the remaining work?

Ans:8.8

10. Find the 5 digit largest number which is divisible by 3 and not by 9?

Ans: 99996

11. Average age of P and his 3 sons is 54 and the age of P is greater than 4 times the son's age. Find the age of P?

Quantitative Aptitude Questions asked in Shift 2:

1. If length is increased by 8% and breadth is decreased by 10% then what is the percentage change in the area of the rectangle.

2. 1 qn from partnership

3. 1 qn from Time & work

4. 1question from triangle

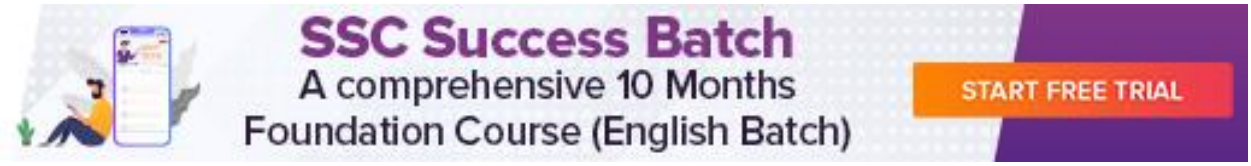

5. A certain principal amounts to Rs 3852 in 3 yrs and Rs 11382 in 5 yrs, find the Rate %

6. 1 qn from circle

7. 1 qn from height & distance

8. 1 qn from average speed

9. 2-3 qns from Algebra

10. 1 qn based on a3 + b3 + c3 – 3abc

Quantitative Aptitude Questions asked in Shift 3:

1. If tan2A + 2 tanA – 63 = 0, then 5sinA + 4 cosA=?

Ans:

1. A sum borrowed is paid back in two equal instalments of Rs 1300(approx) at 4% compounded yearly. What is the total amount paid.

2. The price of sugar is reduced by 15% due to which one can buy 2 kg more sugar for Rs 272. Find the new price of sugar.

3. The water in the frustrum of radii 18 cm and 12 cm and height 35 cm is poured into cylindrical vessel of radius 20 cm, what is the height of the cylindrical vessel?

4. A and B can complete a certain work in 48 days and 60 days respectively. They together work for 12 days and then A quit. B will complete the 25% of the remaining work in:

5. A is the fourth proportional of 3, 5 and 24 and B is the third proportional of 8 and 20 then find 2B + A.

6. A kite is flying at the height of 90 cm making an angle of 30. Find the length of the string.

7. 1 qn from simplification.

8. 2 qns from Algebra.

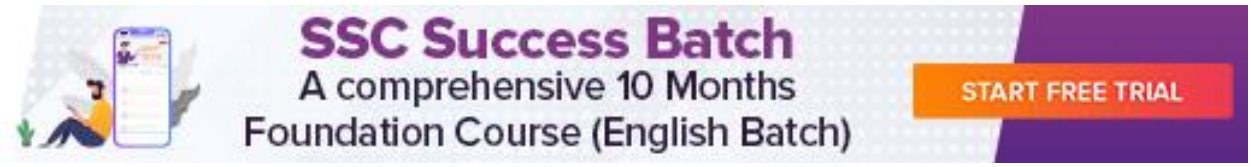

BYJU'S EXAM PREP

Buy Test Series

Unlock All 650+ Mock Tests for SSC & Railway

- Unlimited Access
- All Exams covered
- Designed by Experts
- Performance Analysis

https://byjusexamprep.com